Age 6 to Year 1

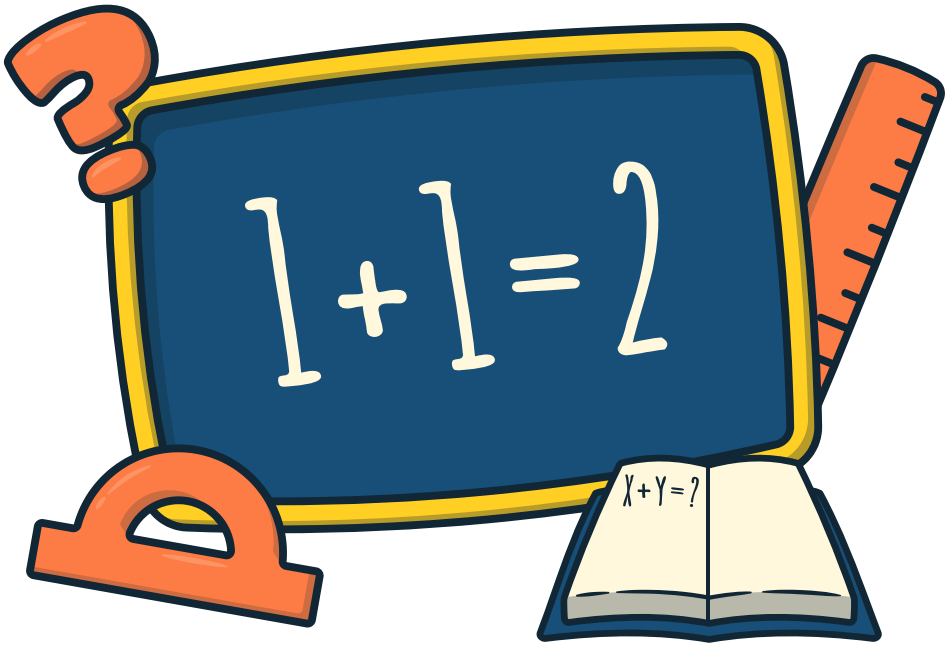

Mathematics

Workbook

Let's add and subtract!

Session 1

1.

		5
+		3

2.

		8
+		6

3.

		7
+		2

4.

		3
+		4

5.

		7
+		9

6.

	1	0
+		6

Let's add and subtract!

Session 2

1. 5 + 7 = _____

2. 10 + 6 = _____

3. 17 + 8 = _____

4. 8 + 9 = _____

5. 12 + 5 = _____

6. 18 + 2 = _____

7. 13 + 7 = _____

8. 15 + 8 = _____

Solving Problems 应用题

1)小明有 6 个苹果。他的爸爸又给了他 5 个。
现在小明一共有多少个苹果?

Xiao Ming has 6 apples. His father gives him 5 more apples.
How many apples does Xiao Ming have now?



👉 _____ 个苹果 _____apples

Number line

NUMBER LINE ADDITION

Example:

$$1 + 2 = \boxed{3}$$

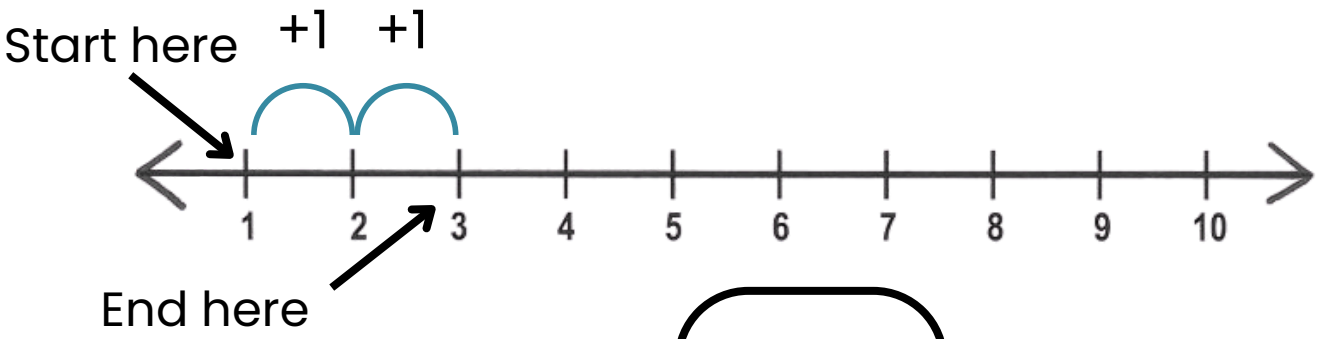

$$2 + 3 = \boxed{5}$$

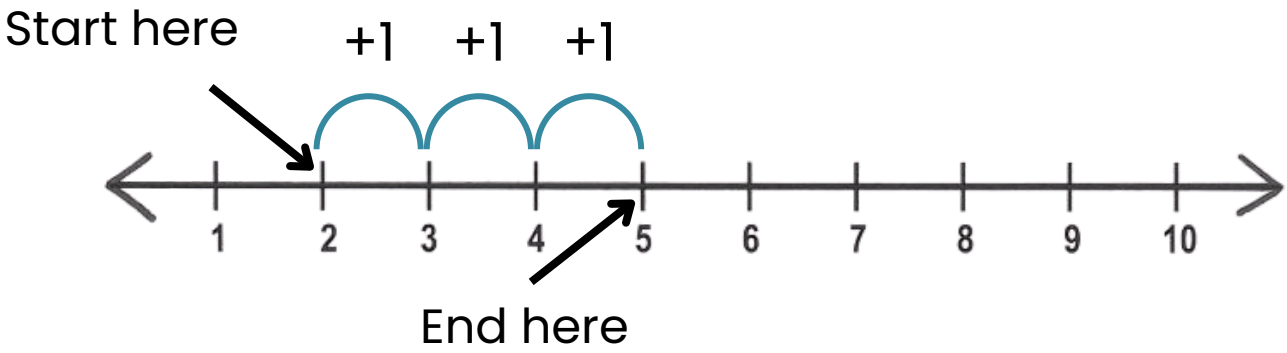

Number line

NUMBER LINE SUBTRACTION

Example:

$$2 - 1 = \boxed{1}$$
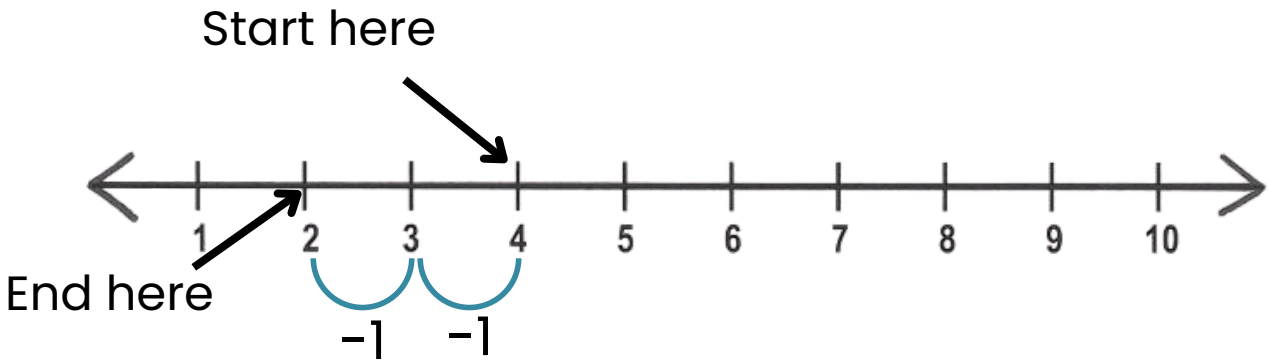
$$4 - 2 = \boxed{2}$$